Year 2011

VCE

Specialist Mathematics

Trial Examination 1

KILBAHA MULTIMEDIA PUBLISHING PO BOX 2227 KEW VIC 3101 AUSTRALIA	TEL: (03) 9018 5376 FAX: (03) 9817 4334 kilbaha@gmail.com http://kilbaha.com.au

© KILBAHA PTY LTD 2011

Copyright Kilbaha Multimedia Publishing

IMPORTANT COPYRIGHT NOTICE

- This material is copyright. Subject to statutory exception and to the provisions of the relevant collective licensing agreements, no reproduction of any part may take place without the written permission of Kilbaha Pty Ltd.
- The contents of this work are copyrighted. Unauthorised copying of any part of this work is illegal and detrimental to the interests of the author.
- For authorised copying within Australia please check that your institution has a licence from Copyright Agency Limited. This permits the copying of small parts of the material, in limited quantities, within the conditions set out in the licence.
- Teachers and students are reminded that for the purposes of school requirements and external assessments, students must submit work that is clearly their own.
- Schools which purchase a licence to use this material may distribute this electronic file to the students at the school for their exclusive use. This distribution can be done either on an Intranet Server or on media for the use on stand-alone computers.
- Schools which purchase a licence to use this material may distribute this printed file to the students at the school for their exclusive use.

- **The Word file (if supplied) is for use ONLY within the school.**
- **It may be modified to suit the school syllabus and for teaching purposes.**
- **All modified versions of the file must carry this copyright notice.**
- **Commercial use of this material is expressly prohibited.**

© KILBAHA PTY LTD 2011

Copyright Kilbaha Multimedia Publishing

Victorian Certificate of Education
2011

STUDENT NUMBER

										Letter
Figures										
Words										

SPECIALIST MATHEMATICS

Trial Written Examination 1

Reading time: 15 minutes
Total writing time: 1 hour

QUESTION AND ANSWER BOOK

Structure of book

Number of questions	*Number of questions to be answered*	*Number of marks*
10	10	40

- Students are permitted to bring into the examination room: pens, pencils, highlighters, erasers, sharpeners, rulers.
- Students are NOT permitted to bring into the examination room: notes of any kind, a calculator, blank sheets of paper and/or white out liquid/tape.

Materials supplied

- Question and answer book of 20 pages with a detachable sheet of miscellaneous formulas at the end of this booklet.
- Working space is provided throughout the booklet.

Instructions

- Detach the formula sheet from the end of this book during reading time.
- Write your **student number** in the space provided above on this page.
- All written responses must be in English.

Students are NOT permitted to bring mobile phones and/or any other unauthorised electronic devices into the examination room.

© KILBAHA PTY LTD 2011

Copyright Kilbaha Multimedia Publishing

Instructions

Answer **all** questions in the spaces provided.
A decimal approximation will not be accepted if an **exact** answer is required to a question.
In questions where more than one mark is available, appropriate working **must** be shown.
Unless otherwise indicated, the diagrams in this book are not drawn to scale.
Take the acceleration due to gravity to have magnitude g m/s^2, where $g = 9.8$

Question 1

Let z be the complex number $z = \sqrt{5} + bi$. If $\text{Arg}(z) = \theta$, $|z| = 3$ and $\text{Im}(z) < 0$, find the value of the real constant k, if $\tan(2\theta) = k\sqrt{5}$.

3 marks

© KILBAHA PTY LTD 2011

Copyright Kilbaha Multimedia Publishing

Question 2

Given the equation $P(z) = z^3 + \left(3i - 3\sqrt{3}\right) z^2 + 5z - 15\sqrt{3} + 15i = 0$

a. Verify that $P\left(3\sqrt{3} - 3i\right) = 0$

1 mark

b. Hence find all values of z if $z^3 + \left(3i - 3\sqrt{3}\right) z^2 + 5z - 15\sqrt{3} + 15i = 0$

2 marks

© KILBAHA PTY LTD 2011

Copyright Kilbaha Multimedia Publishing

Question 3

Sketch the graph of $y = \dfrac{2x^3 - 4}{x}$ on the axes below. Give the exact coordinates of any turning points and intercepts, and state the equations of all asymptotes.

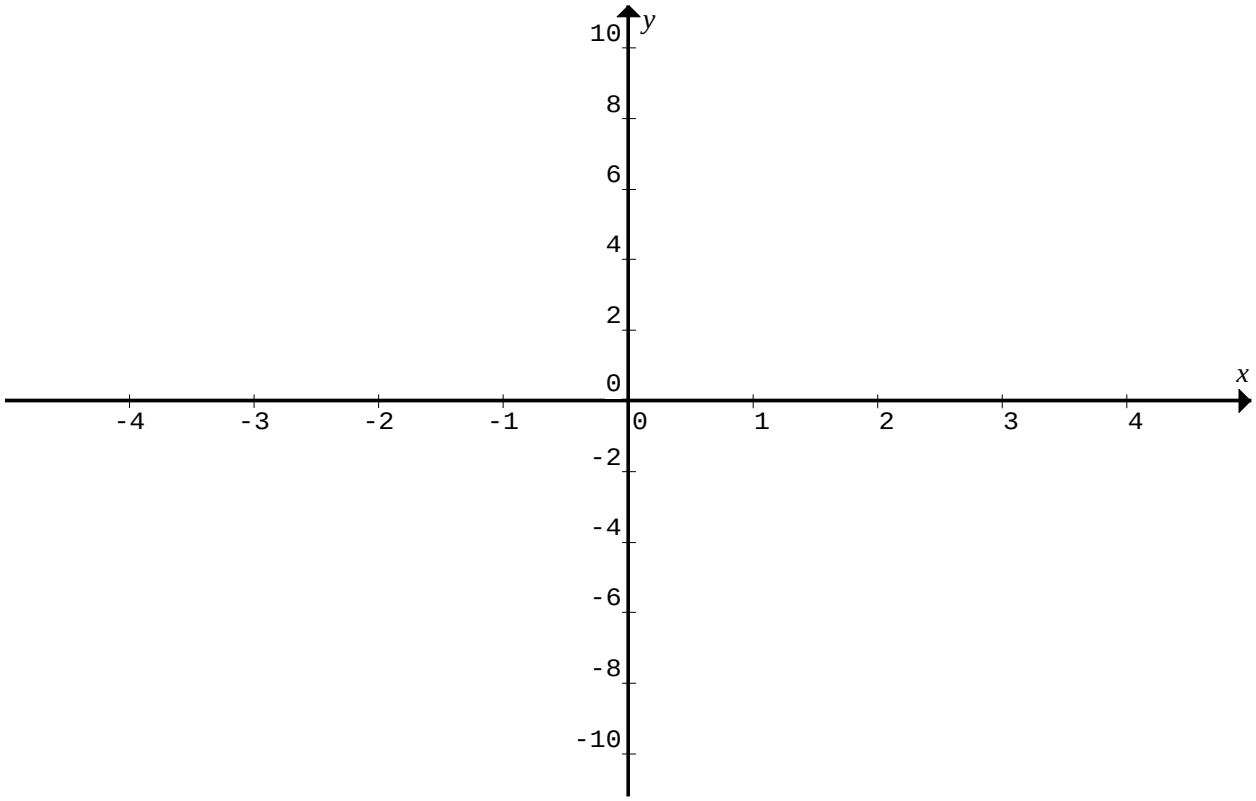

4 marks

© KILBAHA PTY LTD 2011

Copyright Kilbaha Multimedia Publishing

Question 4

A particle is moving in a straight line. The mass of the particle is 2 kg and its velocity is v ms^{-1} when its displacement is x metres from the origin. Initially it is one metre to the right of the origin and is moving with an initial velocity of 4 ms^{-1}. The force acting on the particle is given by $4x^3 + 12x$ newtons.

a. Show that $v = x^2 + 3$

2 marks

b. Hence find the time in seconds when the particle is $\sqrt{3}$ metres from the origin.

4 marks

© KILBAHA PTY LTD 2011

Copyright Kilbaha Multimedia Publishing

Question 5

a. Let $I = \int_a^b \frac{f(x)}{f(x) + f(a+b-x)} dx$ use the substitution $u = a+b-x$, to show that

$I = \int_a^b \frac{f(a+b-x)}{f(a+b-x) + f(x)} dx$ and hence show that $I = \frac{1}{2}(b-a)$.

2 marks

© KILBAHA PTY LTD 2011

Copyright Kilbaha Multimedia Publishing

b. The shaded area shown below is the area bounded by the graph of $y = \dfrac{\sqrt{x}}{\sqrt{5-x}+\sqrt{x}}$, the x-axis and $x = 1$ and $x = 4$. Find the area of the shaded region.

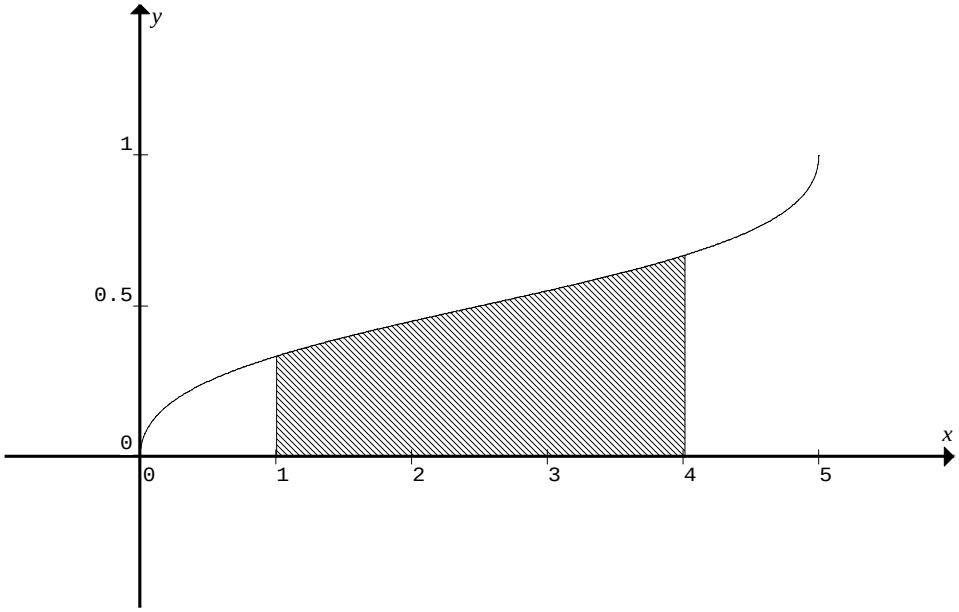

1 mark

© KILBAHA PTY LTD 2011

Copyright Kilbaha Multimedia Publishing

Question 6

The graph of $y = \dfrac{\sqrt{9x^2 - 1}}{2x}$ is shown. A vase is formed, when the graph is rotated about the y-axis, between the x-axis and $y = \sqrt{2}$. Find the volume of the vase.

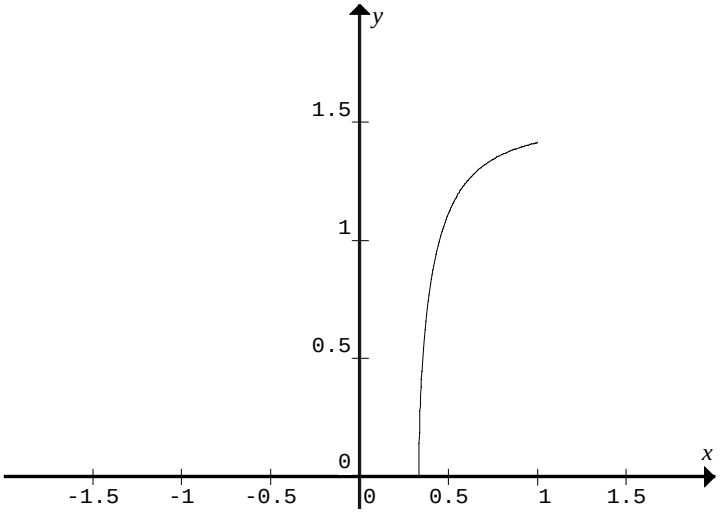

4 marks

© KILBAHA PTY LTD 2011

Copyright Kilbaha Multimedia Publishing

Question 7

a. Use Euler's method to find y_3 if $\frac{dy}{dx} = 2x - y$, given that $y_0 = y(0) = 0$ and $h = \frac{1}{4}$

Express your answer as a fraction.

2 marks

© KILBAHA PTY LTD 2011

Copyright Kilbaha Multimedia Publishing

b. Sketch the slope field of the differential equation $\frac{dy}{dx} = 2x - y$ for $y = -2, -1, 0, 1, 2$ at each of the values $x = -2, -1, 0, 1, 2$ on the axes below.

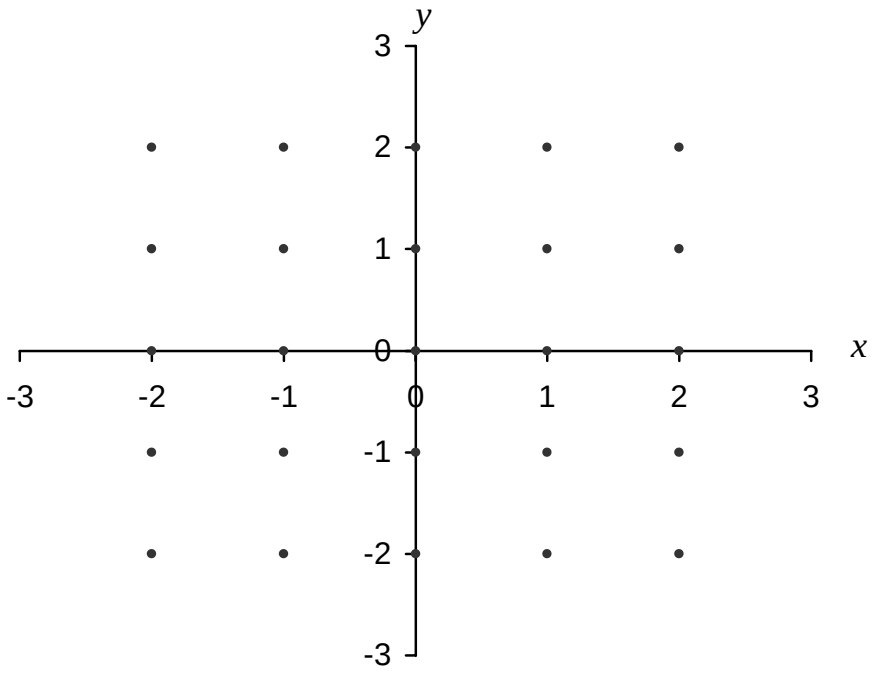

2 marks

© KILBAHA PTY LTD 2011

Copyright Kilbaha Multimedia Publishing

Question 8

a. Differentiate $x\sin^{-1}\left(\frac{2x}{3}\right)$ with respect to x.

2 marks

b. Solve the differential equation $\frac{dy}{dx} = \arcsin\left(\frac{2x}{3}\right)$ given that $x = \frac{3}{2}$ when $y = 0$.

3 marks

© KILBAHA PTY LTD 2011

Copyright Kilbaha Multimedia Publishing

Question 9

A particle is moving along a curve given by

$\underset{\sim}{r}(t) = (t - \sin(t))\,\underset{\sim}{i} + (1 + \cos(t))\,\underset{\sim}{j}$ for $0 \le t \le 2\pi$

a. Show that the speed of the particle at a time t is given by $2\sin\left(\frac{t}{2}\right)$.

2 marks

b. Find the gradient of curve, when $t = \frac{\pi}{3}$

2 marks

© KILBAHA PTY LTD 2011

Copyright Kilbaha Multimedia Publishing

Question 10

a. For the curve $9x^2 + 36x + 4y^2 - 8y + 4 = 0$, find $\frac{dy}{dx}$.

Hence find the coordinates of the points on the curve $9x^2 + 36x + 4y^2 - 8y + 4 = 0$, where the tangent to the curve is parallel to the x-axis.

2 marks

b. Sketch the relation $9x^2 + 36x + 4y^2 - 8y + 4 = 0$ on the next page, stating the domain and range.

© KILBAHA PTY LTD 2011

Copyright Kilbaha Multimedia Publishing

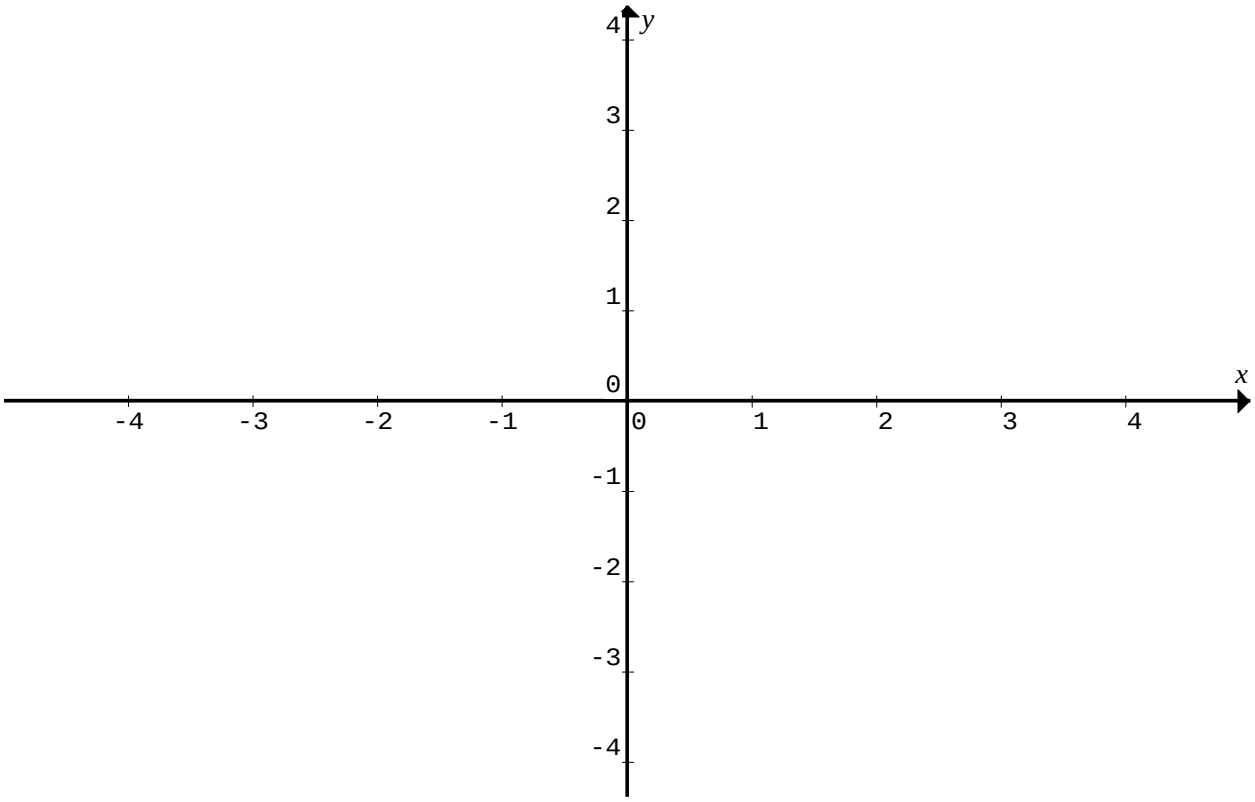

2 marks

END OF EXAMINATION

© KILBAHA PTY LTD 2011

Copyright Kilbaha Multimedia Publishing

SPECIALIST MATHEMATICS

Written examination 1

FORMULA SHEET

Directions to students

Detach this formula sheet during reading time. This formula sheet is provided for your reference.

© KILBAHA PTY LTD 2011

Copyright Kilbaha Multimedia Publishing

Specialist Mathematics Formulas

Mensuration

area of a trapezium:	$\frac{1}{2}(a+b)h$
curved surface area of a cylinder:	$2\pi rh$
volume of a cylinder:	$\pi r^2 h$
volume of a cone:	$\frac{1}{3}\pi r^2 h$
volume of a pyramid:	$\frac{1}{3}Ah$
volume of a sphere:	$\frac{4}{3}\pi r^3$
area of triangle:	$\frac{1}{2}bc\sin(A)$
sine rule:	$\dfrac{a}{\sin(A)}=\dfrac{b}{\sin(B)}=\dfrac{c}{\sin(C)}$
cosine rule:	$c^2=a^2+b^2-2ab\cos(C)$

Coordinate geometry

ellipse: $\dfrac{(x-h)^2}{a^2}+\dfrac{(y-k)^2}{b^2}=1$ hyperbola: $\dfrac{(x-h)^2}{a^2}-\dfrac{(y-k)^2}{b^2}=1$

Circular (trigonometric) functions

$\cos^2(x)+\sin^2(x)=1$

$1+\tan^2(x)=\sec^2(x)$ $\cot^2(x)+1=\operatorname{cosec}^2(x)$

$\sin(x+y)=\sin(x)\cos(y)+\cos(x)\sin(y)$ $\sin(x-y)=\sin(x)\cos(y)-\cos(x)\sin(y)$

$\cos(x+y)=\cos(x)\cos(y)-\sin(x)\sin(y)$ $\cos(x-y)=\cos(x)\cos(y)+\sin(x)\sin(y)$

$\tan(x+y)=\dfrac{\tan(x)+\tan(y)}{1-\tan(x)\tan(y)}$ $\tan(x-y)=\dfrac{\tan(x)-\tan(y)}{1+\tan(x)\tan(y)}$

$\cos(2x)=\cos^2(x)-\sin^2(x)=2\cos^2(x)-1=1-2\sin^2(x)$

$\sin(2x)=2\sin(x)\cos(x)$ $\tan(2x)=\dfrac{2\tan(x)}{1-\tan^2(x)}$

© KILBAHA PTY LTD 2011

Copyright Kilbaha Multimedia Publishing

function	$\sin^{-1}$	$\cos^{-1}$	$\tan^{-1}$
domain	$[-1,1]$	$[-1,1]$	R
range	$\left[-\frac{\pi}{2},\frac{\pi}{2}\right]$	$[0,\pi]$	$\left(-\frac{\pi}{2},\frac{\pi}{2}\right)$

Algebra (Complex Numbers)

$z = x + yi = r\left(\cos(\theta) + i\sin(\theta)\right) = r\,\mathrm{cis}(\theta)$

$|z| = \sqrt{x^2 + y^2} = r$ $\qquad -\pi < \mathrm{Arg}(z) \le \pi$

$z_1 z_2 = r_1 r_2\,\mathrm{cis}(\theta_1 + \theta_2)$ $\qquad \frac{z_1}{z_2} = \frac{r_1}{r_2}\,\mathrm{cis}(\theta_1 - \theta_2)$

$z^n = r^n\mathrm{cis}(n\theta)$ (de Moivre's theorem)

Vectors in two and three dimensions

$\underset{\sim}{r} = x\underset{\sim}{i} + y\underset{\sim}{j} + z\underset{\sim}{k}$

$|\underset{\sim}{r}| = \sqrt{x^2 + y^2 + z^2} = r$ $\qquad \underset{\sim}{r_1} \cdot \underset{\sim}{r_2} = r_1 r_2 \cos(\theta) = x_1 x_2 + y_1 y_2 + z_1 z_2$

$\dot{\underset{\sim}{r}} = \frac{d\underset{\sim}{r}}{dt} = \frac{dx}{dt}\underset{\sim}{i} + \frac{dy}{dt}\underset{\sim}{j} + \frac{dz}{dt}\underset{\sim}{k}$

Mechanics

momentum: $\underset{\sim}{p} = m\underset{\sim}{v}$

equation of motion: $\underset{\sim}{R} = m\underset{\sim}{a}$

sliding friction: $F \le \mu N$

constant (uniform) acceleration:

$v = u + at$ $\qquad s = ut + \frac{1}{2}at^2$ $\qquad v^2 = u^2 + 2as$ $\qquad s = \frac{1}{2}(u+v)t$

acceleration: $a = \frac{d^2x}{dt^2} = \frac{dv}{dt} = v\frac{dv}{dx} = \frac{d}{dx}\left(\frac{1}{2}v^2\right)$

© KILBAHA PTY LTD 2011

Copyright Kilbaha Multimedia Publishing

Calculus

$$\frac{d}{dx}\left(x^n\right) = nx^{n-1}$$

$$\int x^n dx = \frac{1}{n+1}x^{n+1} + c \ , \ n \neq -1$$

$$\frac{d}{dx}\left(e^{ax}\right) = ae^{ax}$$

$$\int e^{ax} dx = \frac{1}{a}e^{ax} + c$$

$$\frac{d}{dx}\left(\log_e(x)\right) = \frac{1}{x}$$

$$\int \frac{1}{x} dx = \log_e(x) + c, \text{ for } x > 0$$

$$\frac{d}{dx}\left(\sin(ax)\right) = a\cos(ax)$$

$$\int \sin(ax)\, dx = -\frac{1}{a}\cos(ax) + c$$

$$\frac{d}{dx}\left(\cos(ax)\right) = -a\sin(ax)$$

$$\int \cos(ax)\, dx = \frac{1}{a}\sin(ax) + c$$

$$\frac{d}{dx}\left(\tan(ax)\right) = a\sec^2(ax)$$

$$\int \sec^2(ax)\, dx = \frac{1}{a}\tan(ax) + c$$

$$\frac{d}{dx}\left(\sin^{-1}(x)\right) = \frac{1}{\sqrt{1-x^2}}$$

$$\int \frac{dx}{\sqrt{a^2 - x^2}} = \sin^{-1}\left(\frac{x}{a}\right) + c, \ a > 0$$

$$\frac{d}{dx}\left(\cos^{-1}(x)\right) = \frac{-1}{\sqrt{1-x^2}}$$

$$\int \frac{-1}{\sqrt{a^2 - x^2}} dx = \cos^{-1}\left(\frac{x}{a}\right) + c, \ a > 0$$

$$\frac{d}{dx}\left(\tan^{-1}(x)\right) = \frac{1}{1+x^2}$$

$$\int \frac{a}{a^2 + x^2} dx = \tan^{-1}\left(\frac{x}{a}\right) + c$$

product rule: $\frac{d}{dx}(uv) = u\frac{dv}{dx} + v\frac{du}{dx}$

quotient rule: $\frac{d}{dx}\left(\frac{u}{v}\right) = \frac{v\frac{du}{dx} - u\frac{dv}{dx}}{v^2}$

chain rule: $\frac{dy}{dx} = \frac{dy}{du}\frac{du}{dx}$

Euler's method If $\frac{dy}{dx} = f(x), x_0 = a$ and $y_0 = b,$ then $x_{n+1} = x_n + h$ and $y_{n+1} = y_n + hf\left(x_n\right)$

END OF FORMULA SHEET

© KILBAHA PTY LTD 2011

Copyright Kilbaha Multimedia Publishing